Name_____ Date_____

Time Signatures - 𝄵, 𝄵



In 𝄵 time there are two beats in each measure.
The half note gets one beat.

Rhythmic values
- A quarter note (♩) = 1/2 beat
- A half note (𝅗𝅥) = 1 beat
- A whole note (𝅝) = 6 beats

𝄵 is often referred to as "cut" time.

𝄵 may also be displayed as 𝄵.

---

1. Clap the rhythm while counting out loud.

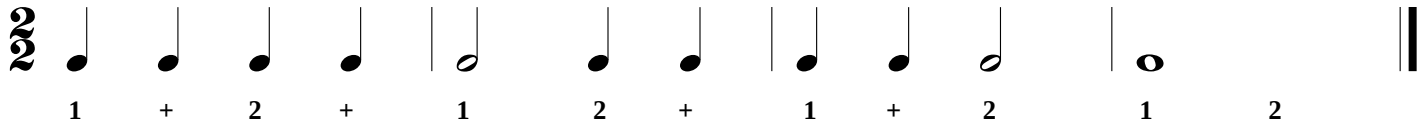

2. Write the count below the notes and then clap the rhythm while counting out loud.

3. Write a 𝄵 time signature after the clef sign.
Write the count below the notes and then clap the rhythm while counting out loud.



4. Write a 𝄵 time signature after the clef sign. Write in the count below the notes. Draw the missing bar lines.



5. Write in the count below the notes and add the missing barlines.



Finale® Worksheets, Copyright © 2009 by MakeMusic, Inc.
MakeMusic grants permission to duplicate this worksheet for non-profit, educational use only, provided each copy includes this copyright notice.
Copies may not be sold or included in any materials offered for sale to the general public.